Counting Figures Name:

**Count the number of shapes in each box.**

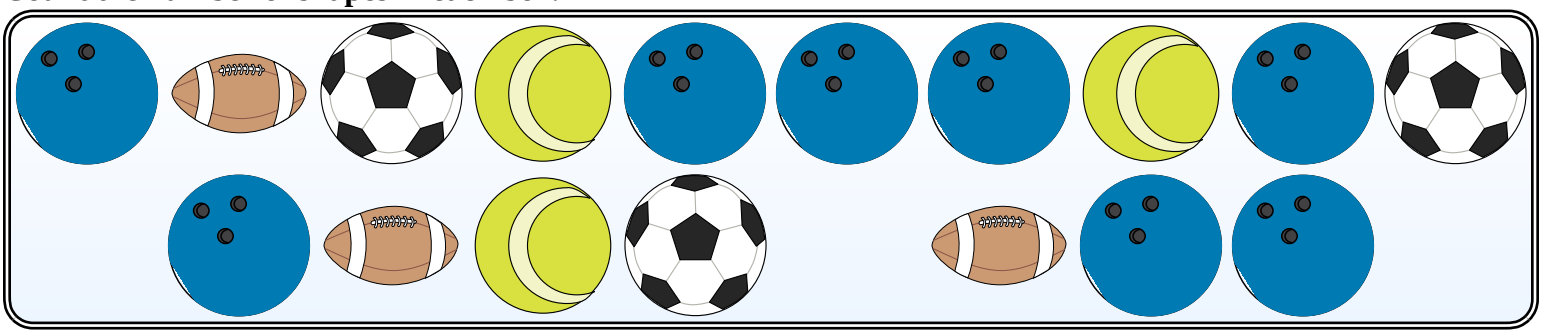

**Ex)** = 8

**1)** = _____

**2)** = _____

**3)** = _____



**4)** = _____

**5)** = _____

**6)** = _____

**7)** = _____

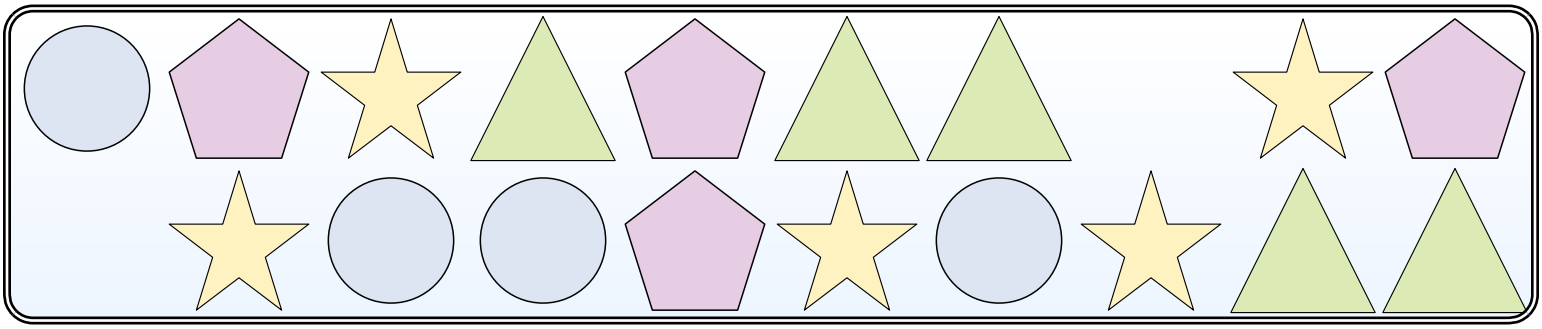

**8)** = _____

**9)** 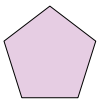 = _____

**10)** = _____

**11)** = _____



| | | | | | | | | | | |
|---|---|---|---|---|---|---|---|---|---|---|
| 1-10 | 91 | 82 | 73 | 64 | 55 | 45 | 36 | 27 | 18 | 9 |
| 11 | 0 | | | | | | | | | |

Counting Figures

Name: **Answer Key**

**Count the number of shapes in each box.**

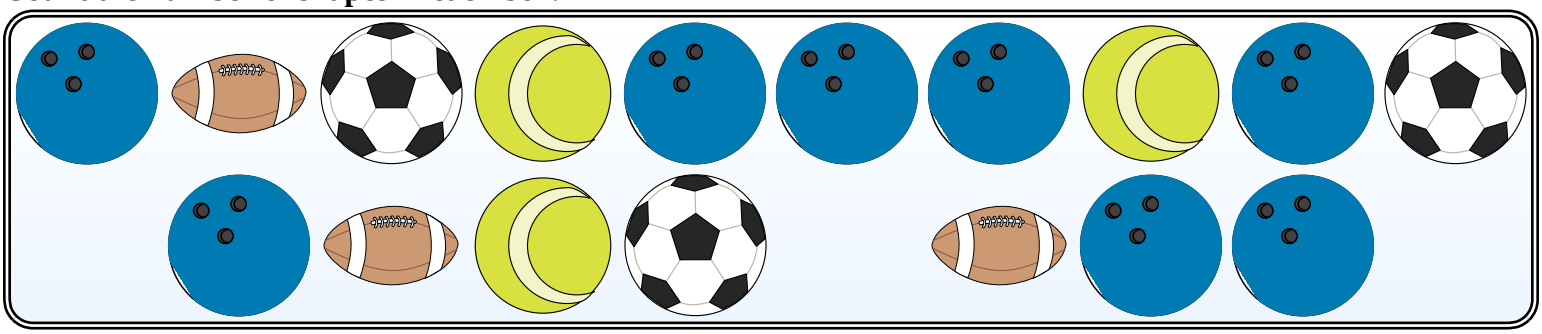

**Ex)** = 8

**1)** = 3

**2)** = 3

**3)** = 3



**4)** = 6

**5)** = 5

**6)** = 4

**7)** = 3

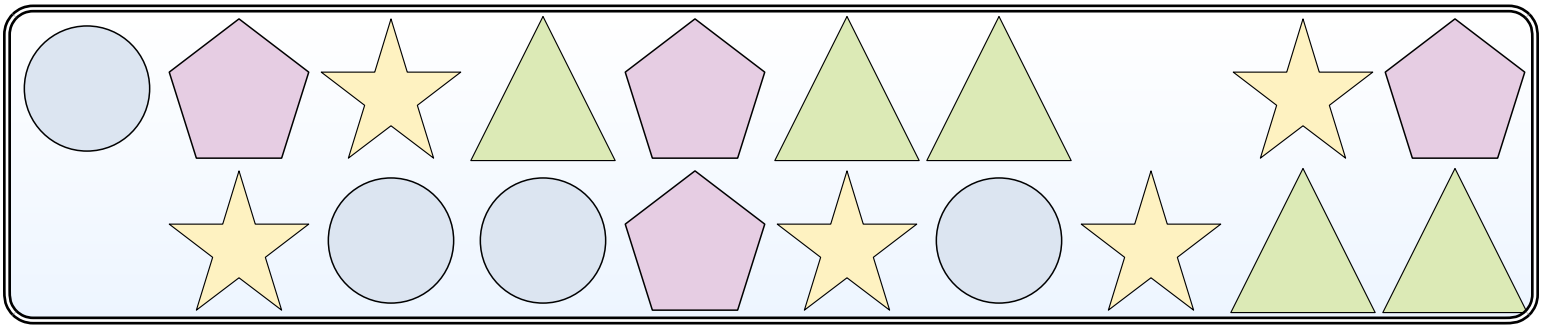

**8)** = 4

**9)** 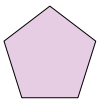 = 4

**10)** = 5

**11)** = 5



| | | | | | | | | | | |
|---|---|---|---|---|---|---|---|---|---|---|
| 1-10 | 91 | 82 | 73 | 64 | 55 | 45 | 36 | 27 | 18 | 9 |
| 11 | 0 | | | | | | | | | |