Function Machines (Add & Subtract) Name:

Determine the rule each function machine is using.

Ex)

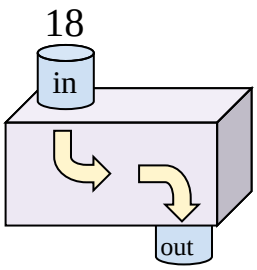

Add 9

1)

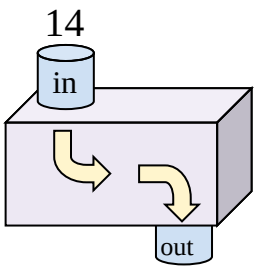

2)

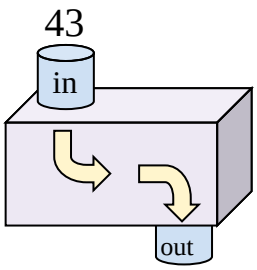

3)

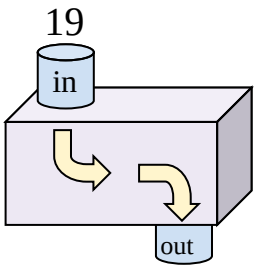

4)

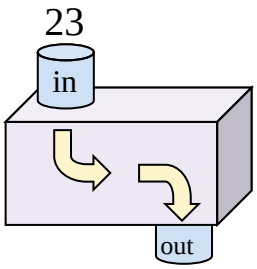

5)

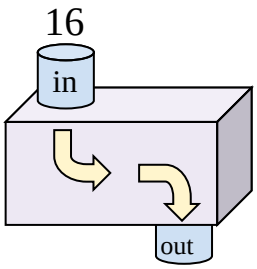

6)

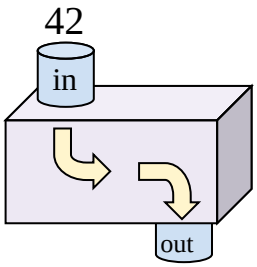

7)

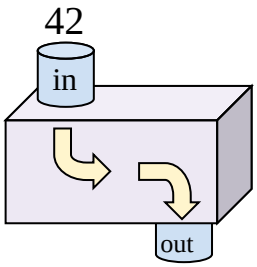

8)

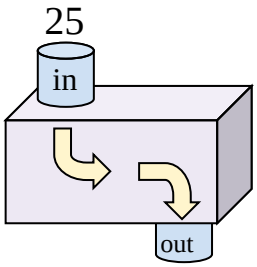

9)

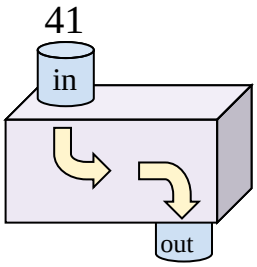

10)

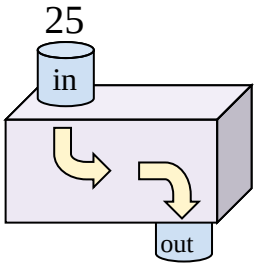

11)

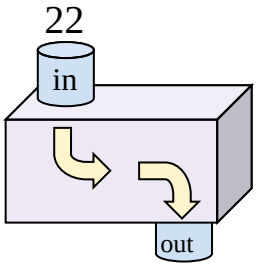

Answers

Ex. Add 9

1. _____
2. _____
3. _____
4. _____
5. _____
6. _____
7. _____
8. _____
9. _____
10. _____
11. _____

Function Machines (Add & Subtract) Name: **Answer Key**

Determine the rule each function machine is using.

Ex)

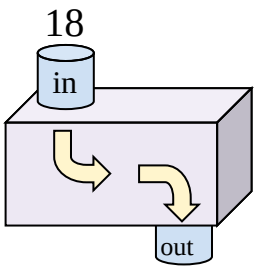

Add 9

1)

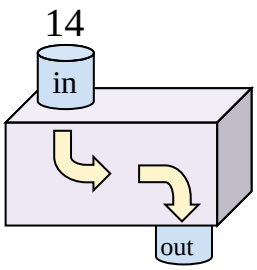

Add 11

2)

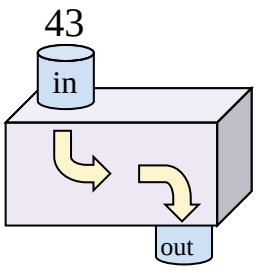

Subtract 13

3)

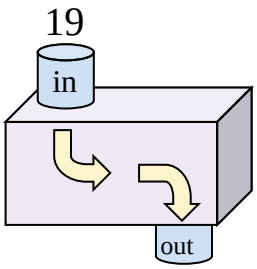

Add 28

4)

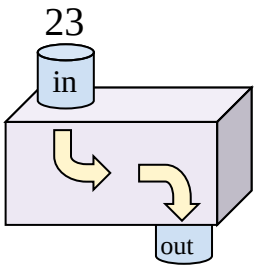

Add 23

5)

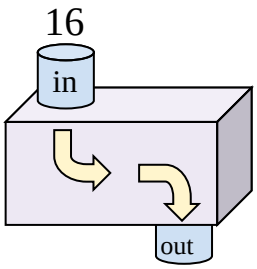

Add 9

6)

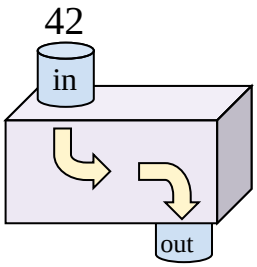

Subtract 17

7)

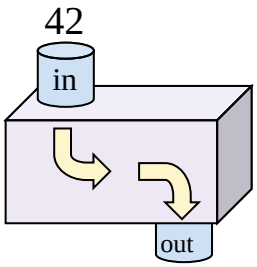

Subtract 25

8)

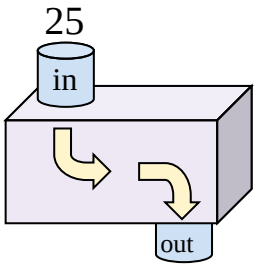

Subtract 10

9)

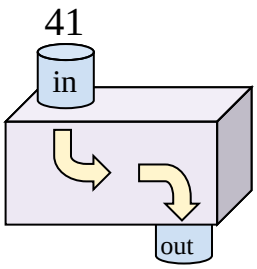

Subtract 29

10)

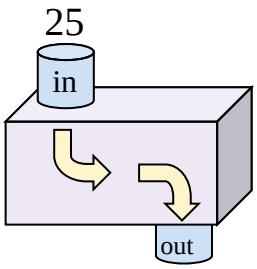

Add 23

11)

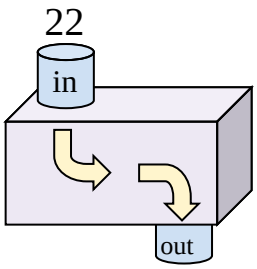

Subtract 8

Answers

Ex. **Add 9**

1. **Add 11**
2. **Subtract 13**
3. **Add 28**
4. **Add 23**
5. **Add 9**
6. **Subtract 17**
7. **Subtract 25**
8. **Subtract 10**
9. **Subtract 29**
10. **Add 23**
11. **Subtract 8**