Fraction Quantity Relative to Whole

Name:

Solve each problem.

Ex) Express the stars as a fraction of the entire set.

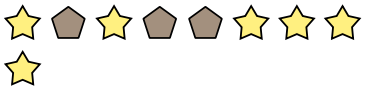

1) Express the circles as a fraction of the entire set.

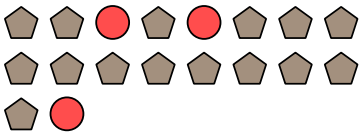

2) Express the circles as a fraction of the entire set.

3) Express the triangles as a fraction of the entire set.



4) Express the circles as a fraction of the entire set.

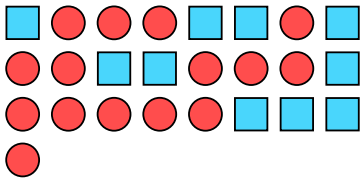

5) Express the hearts as a fraction of the entire set.

6) Express the circles as a fraction of the entire set.

7) Express the hearts as a fraction of the entire set.

8) Express the pentagons as a fraction of the entire set.

9) Express the stars as a fraction of the entire set.



10) Express the squares as a fraction of the entire set.

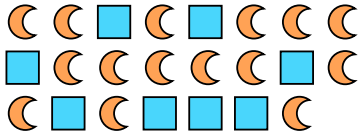

11) Express the stars as a fraction of the entire set.



Answers

Ex. $\frac{6}{9}$

1. _____
2. _____
3. _____
4. _____
5. _____
6. _____
7. _____
8. _____
9. _____
10. _____
11. _____

1-10	91	82	73	64	55	45	36	27	18	9
11	0									

Fraction Quantity Relative to Whole

Name: **Answer Key**

Solve each problem.

Ex) Express the stars as a fraction of the entire set.

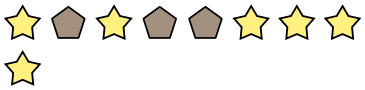

1) Express the circles as a fraction of the entire set.

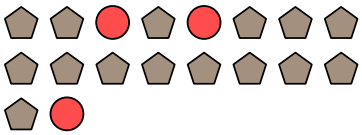

2) Express the circles as a fraction of the entire set.

3) Express the triangles as a fraction of the entire set.



4) Express the circles as a fraction of the entire set.

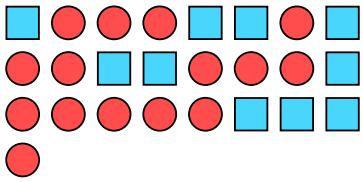

5) Express the hearts as a fraction of the entire set.

6) Express the circles as a fraction of the entire set.

7) Express the hearts as a fraction of the entire set.

8) Express the pentagons as a fraction of the entire set.

9) Express the stars as a fraction of the entire set.



10) Express the squares as a fraction of the entire set.

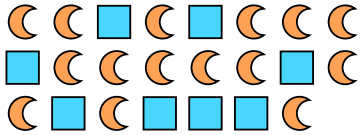

11) Express the stars as a fraction of the entire set.



Answers

Ex.	6/9
1.	3/18
2.	4/9
3.	4/17
4.	15/25
5.	2/15
6.	3/7
7.	5/11
8.	5/9
9.	5/20
10.	8/23
11.	13/19

1-10	91	82	73	64	55	45	36	27	18	9
11	0									