Fraction Quantity Relative to Whole

Name:

Solve each problem.

Ex) Express the moons as a fraction of the entire set.

1) Express the squares as a fraction of the entire set.

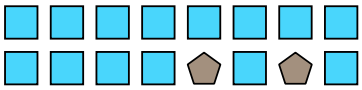

2) Express the stars as a fraction of the entire set.

3) Express the stars as a fraction of the entire set.



4) Express the moons as a fraction of the entire set.



5) Express the squares as a fraction of the entire set.

6) Express the triangles as a fraction of the entire set.

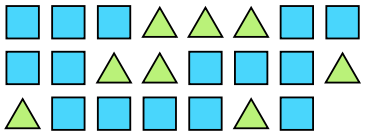

7) Express the stars as a fraction of the entire set.



8) Express the stars as a fraction of the entire set.

9) Express the triangles as a fraction of the entire set.

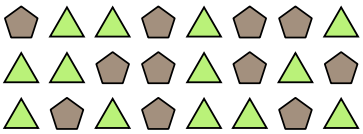

10) Express the circles as a fraction of the entire set.

11) Express the hearts as a fraction of the entire set.

Answers

Ex. $\frac{6}{8}$

1. _____
2. _____
3. _____
4. _____
5. _____
6. _____
7. _____
8. _____
9. _____
10. _____
11. _____

1-10	91	82	73	64	55	45	36	27	18	9
11	0									

Fraction Quantity Relative to Whole

Name: **Answer Key**

Solve each problem.

Ex) Express the moons as a fraction of the entire set.

1) Express the squares as a fraction of the entire set.

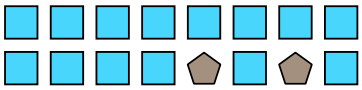

2) Express the stars as a fraction of the entire set.

3) Express the stars as a fraction of the entire set.



4) Express the moons as a fraction of the entire set.



5) Express the squares as a fraction of the entire set.

6) Express the triangles as a fraction of the entire set.

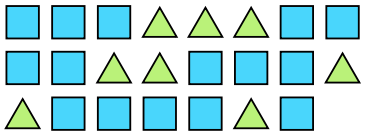

7) Express the stars as a fraction of the entire set.



8) Express the stars as a fraction of the entire set.

9) Express the triangles as a fraction of the entire set.

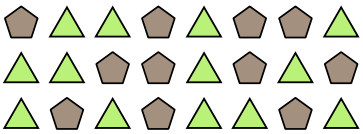

10) Express the circles as a fraction of the entire set.

11) Express the hearts as a fraction of the entire set.

Answers

Ex.	6/8
1.	14/16
2.	11/19
3.	13/25
4.	5/14
5.	4/7
6.	8/23
7.	9/24
8.	6/13
9.	13/24
10.	3/5
11.	3/12

1-10	91	82	73	64	55	45	36	27	18	9
11	0									