Fraction, Decimal & Percent (Visual)

Name:

Determine the value written as a fraction , decimal & a percent.

Ex)

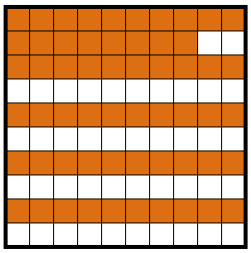

fraction $^{58}/_{100}$
decimal 0.58
percent 58

1)

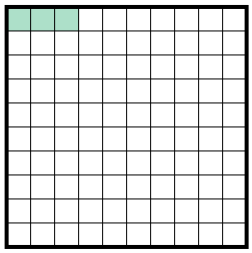

fraction _____
decimal _____
percent _____

2)

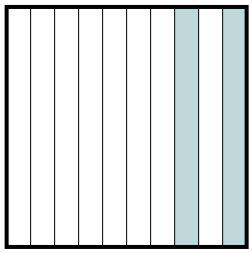

fraction _____
decimal _____
percent _____

3)



fraction _____
decimal _____
percent _____

4)

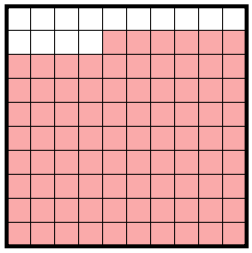

fraction _____
decimal _____
percent _____

5)

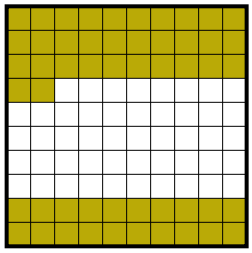

fraction _____
decimal _____
percent _____

6)

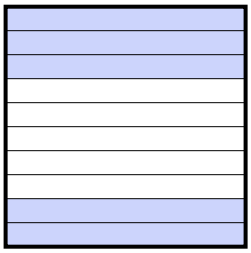

fraction _____
decimal _____
percent _____

7)

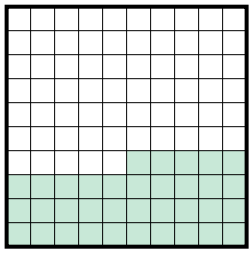

fraction _____
decimal _____
percent _____

8)

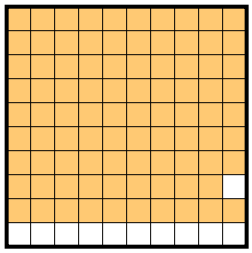

fraction _____
decimal _____
percent _____

9)

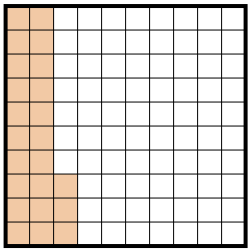

fraction _____
decimal _____
percent _____

10)

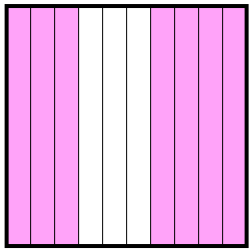

fraction _____
decimal _____
percent _____

11)

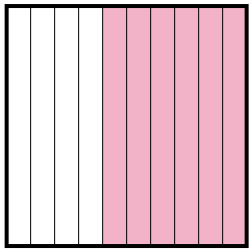

fraction _____
decimal _____
percent _____

Answers

Ex.	$^{58}/_{100}$	0.58	58%
1.			
2.			
3.			
4.			
5.			
6.			
7.			
8.			
9.			
10.			
11.			

1-10	91	82	73	64	55	45	36	27	18	9
11	0									

Fraction, Decimal & Percent (Visual) Name: **Answer Key**

Determine the value written as a fraction , decimal & a percent.

Ex)

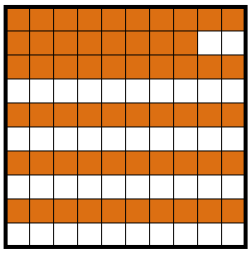

fraction $^{58}/_{100}$
decimal 0.58
percent 58

1)

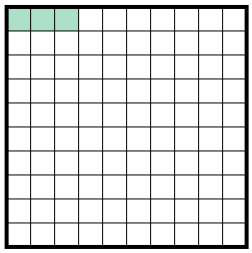

fraction $^{3}/_{100}$
decimal 0.03
percent 3

2)

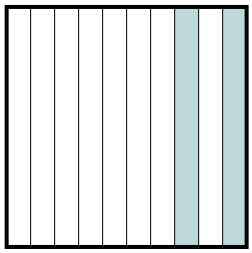

fraction $^{2}/_{10}$
decimal 0.2
percent 20

3)



fraction $^{4}/_{10}$
decimal 0.4
percent 40

4)

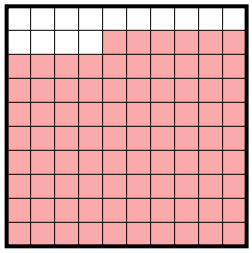

fraction $^{86}/_{100}$
decimal 0.86
percent 86

5)

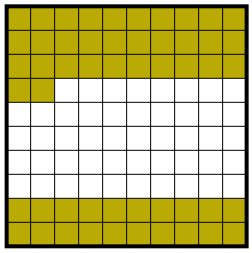

fraction $^{52}/_{100}$
decimal 0.52
percent 52

6)

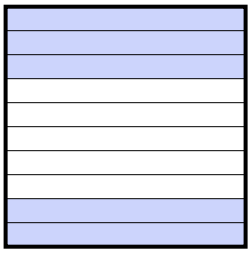

fraction $^{5}/_{10}$
decimal 0.5
percent 50

7)

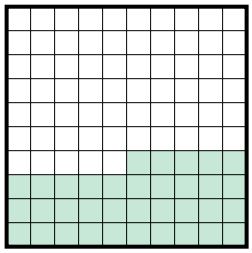

fraction $^{35}/_{100}$
decimal 0.35
percent 35

8)

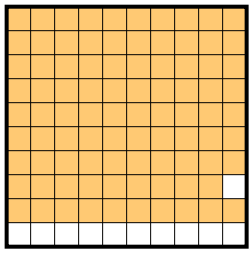

fraction $^{89}/_{100}$
decimal 0.89
percent 89

9)

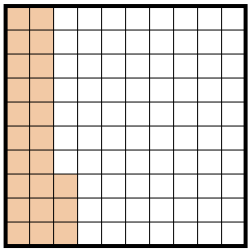

fraction $^{23}/_{100}$
decimal 0.23
percent 23

10)

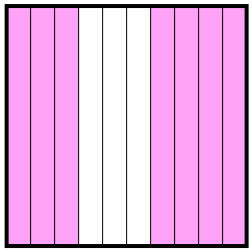

fraction $^{7}/_{10}$
decimal 0.7
percent 70

11)

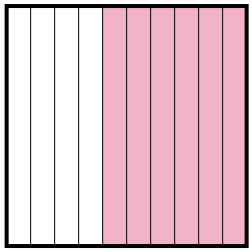

fraction $^{6}/_{10}$
decimal 0.6
percent 60

Answers

Ex.	$^{58}/_{100}$	0.58	58%
1.	$^{3}/_{100}$	0.03	3%
2.	$^{2}/_{10}$	0.2	20%
3.	$^{4}/_{10}$	0.4	40%
4.	$^{86}/_{100}$	0.86	86%
5.	$^{52}/_{100}$	0.52	52%
6.	$^{5}/_{10}$	0.5	50%
7.	$^{35}/_{100}$	0.35	35%
8.	$^{89}/_{100}$	0.89	89%
9.	$^{23}/_{100}$	0.23	23%
10.	$^{7}/_{10}$	0.7	70%
11.	$^{6}/_{10}$	0.6	60%

1-10	91	82	73	64	55	45	36	27	18	9
11	0									