Visual Division Name:

Use the shapes provided to answer the questions.

Ex) How many groups of 6 can you make with the 18 shapes below?

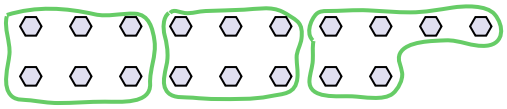

1) How many groups of 6 can you make with the 12 shapes below?

2) How many groups of 7 can you make with the 35 shapes below?

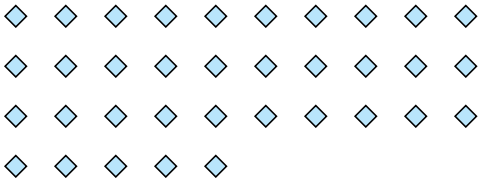

3) How many groups of 4 can you make with the 8 shapes below?

4) How many groups of 8 can you make with the 24 shapes below?



5) How many groups of 4 can you make with the 40 shapes below?

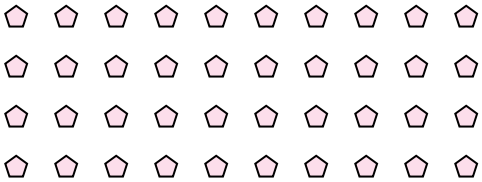

6) How many groups of 6 can you make with the 36 shapes below?



7) How many groups of 5 can you make with the 10 shapes below?

8) How many groups of 9 can you make with the 27 shapes below?



9) How many groups of 8 can you make with the 32 shapes below?



10) How many groups of 6 can you make with the 18 shapes below?

11) How many groups of 2 can you make with the 26 shapes below?

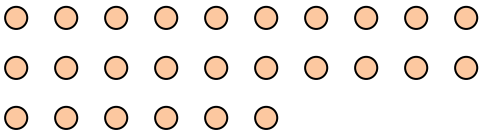

Answers

Ex. 3

1. _____
2. _____
3. _____
4. _____
5. _____
6. _____
7. _____
8. _____
9. _____
10. _____
11. _____

1-10	91	82	73	64	55	45	36	27	18	9
11	0									

Visual Division

Name: **Answer Key**

Use the shapes provided to answer the questions.

Ex) How many groups of 6 can you make with the 18 shapes below?

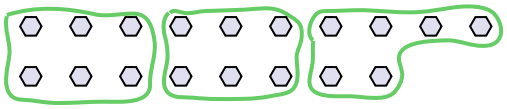

1) How many groups of 6 can you make with the 12 shapes below?

2) How many groups of 7 can you make with the 35 shapes below?

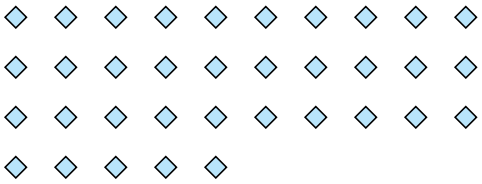

3) How many groups of 4 can you make with the 8 shapes below?

4) How many groups of 8 can you make with the 24 shapes below?



5) How many groups of 4 can you make with the 40 shapes below?

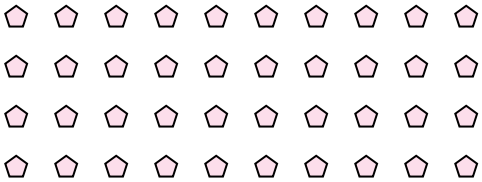

6) How many groups of 6 can you make with the 36 shapes below?



7) How many groups of 5 can you make with the 10 shapes below?

8) How many groups of 9 can you make with the 27 shapes below?



9) How many groups of 8 can you make with the 32 shapes below?



10) How many groups of 6 can you make with the 18 shapes below?

11) How many groups of 2 can you make with the 26 shapes below?

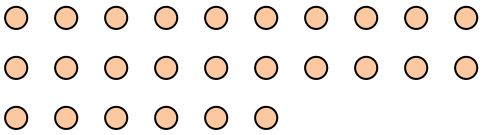

Answers

Ex.	3
1.	2
2.	5
3.	2
4.	3
5.	10
6.	6
7.	2
8.	3
9.	4
10.	3
11.	13

1-10	91	82	73	64	55	45	36	27	18	9
11	0									