Dividing with a Numberline

Name:

Use the numberline to solve each problem.

1) 12÷6=

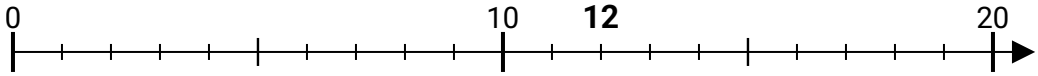

2) 20÷4=

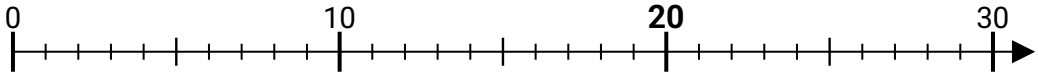

3) 36÷9=

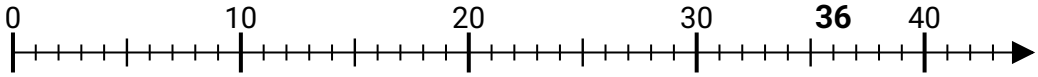

4) 16÷8=

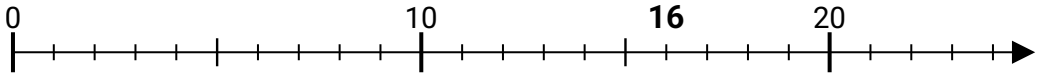

5) 6÷3=

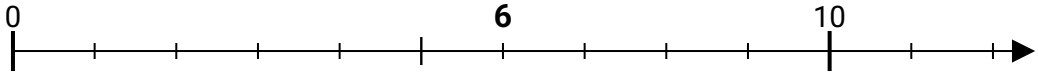

6) 25÷5=

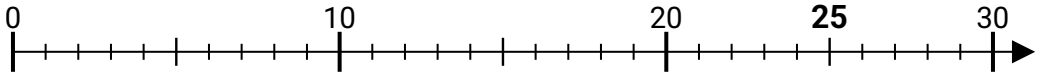

7) 18÷9=

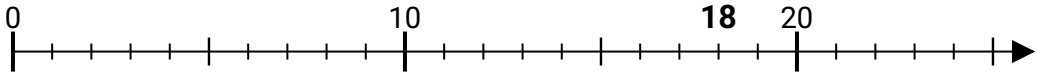

8) 16÷4=

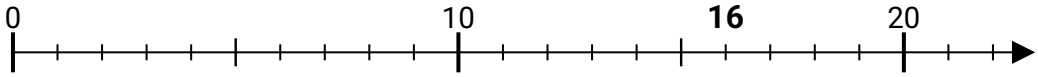

9) 12÷3=

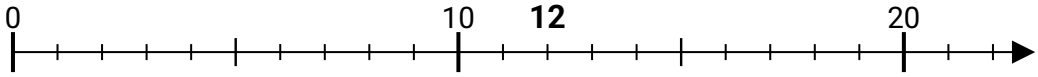

10) 9÷3=

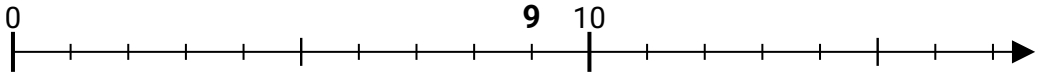

11) 10÷2=

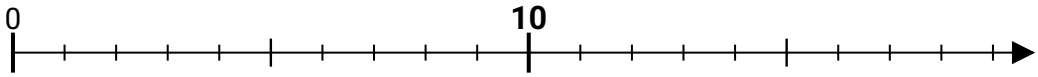

Answers

1. _____
2. _____
3. _____
4. _____
5. _____
6. _____
7. _____
8. _____
9. _____
10. _____
11. _____

1-10	91	82	73	64	55	45	36	27	18	9
11	0									

Dividing with a Numberline

Name: **Answer Key**

Use the numberline to solve each problem.

1) 12÷6=

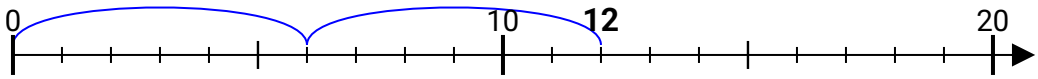

2) 20÷4=

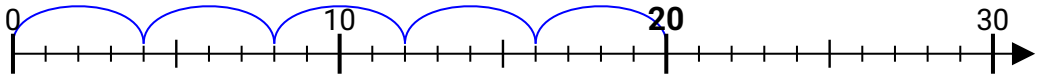

3) 36÷9=

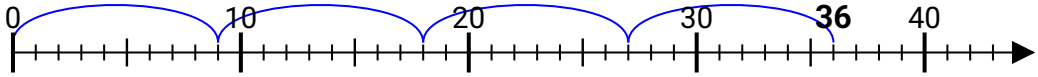

4) 16÷8=

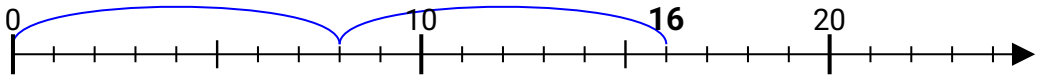

5) 6÷3=

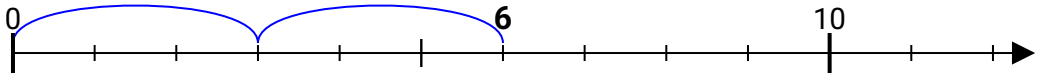

6) 25÷5=

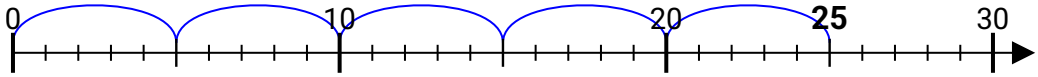

7) 18÷9=

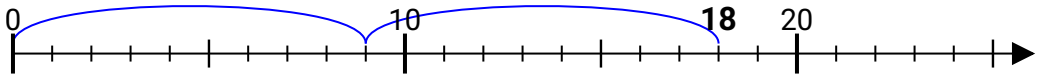

8) 16÷4=

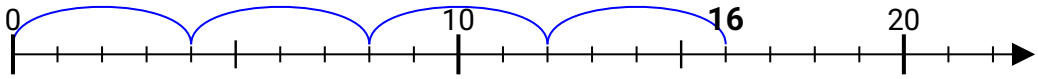

9) 12÷3=

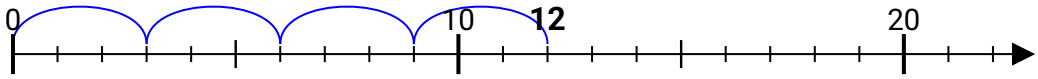

10) 9÷3=

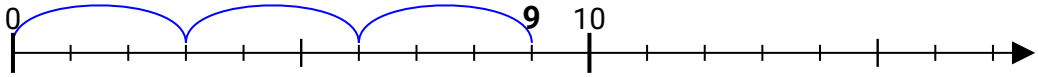

11) 10÷2=

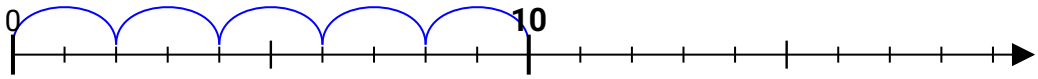

Answers

1. 2
2. 5
3. 4
4. 2
5. 2
6. 5
7. 2
8. 4
9. 4
10. 3
11. 5