Visual Place Value (Less than 20) Name:

**Fill in the blanks to find the amounts.**

**Ex)**

0 4

tens ones

**1)**

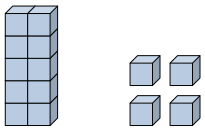

tens ones

**2)**

tens ones

**3)**

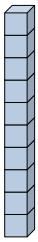

tens ones

**4)**

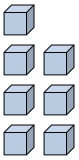

tens ones

**5)**

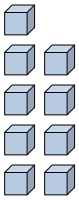

tens ones

**6)**

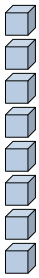

tens ones

**7)**

tens ones

**8)**

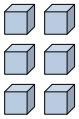

tens ones

**9)**

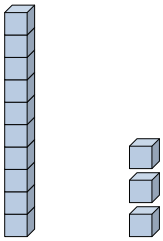

tens ones

**10)**

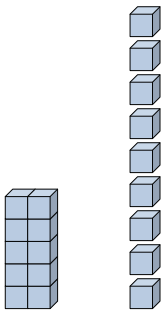

tens ones

**11)**

tens ones

## Answers

Ex. 4

1. _____
2. _____
3. _____
4. _____
5. _____
6. _____
7. _____
8. _____
9. _____
10. _____
11. _____



| | | | | | | | | | | |
|---|---|---|---|---|---|---|---|---|---|---|
| 1-10 | 91 | 82 | 73 | 64 | 55 | 45 | 36 | 27 | 18 | 9 |
| 11 | 0 | | | | | | | | | |

Visual Place Value (Less than 20) Name: **Answer Key**

**Fill in the blanks to find the amounts.**

**Ex)**

0 tens 4 ones

**1)**

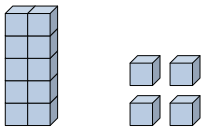

1 tens 4 ones

**2)**

0 tens 1 ones

**3)**

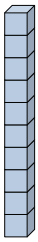

1 tens 0 ones

**4)**

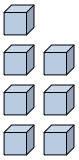

0 tens 7 ones

**5)**

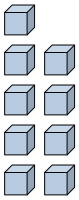

0 tens 9 ones

**6)**

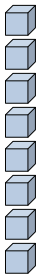

0 tens 8 ones

**7)**

0 tens 2 ones

**8)**

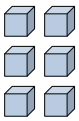

0 tens 6 ones

**9)**

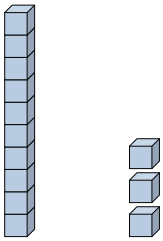

1 tens 3 ones

**10)**

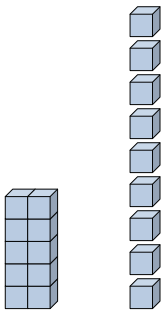

1 tens 9 ones

**11)**

0 tens 3 ones

## Answers

| | |
|---|---|
| Ex. | 4 |
| 1. | 14 |
| 2. | 1 |
| 3. | 10 |
| 4. | 7 |
| 5. | 9 |
| 6. | 8 |
| 7. | 2 |
| 8. | 6 |
| 9. | 13 |
| 10. | 19 |
| 11. | 3 |



| | | | | | | | | | | |
|---|---|---|---|---|---|---|---|---|---|---|
| 1-10 | 91 | 82 | 73 | 64 | 55 | 45 | 36 | 27 | 18 | 9 |
| 11 | 0 | | | | | | | | | |