Determining Symmetry

Name:

Determine if the line through the figure is a line of symmetry.

Ex)

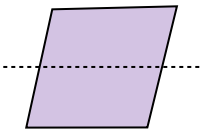

1)

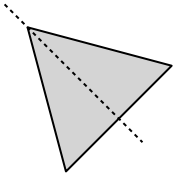

2)

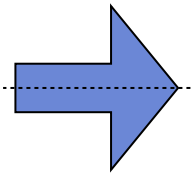

3)

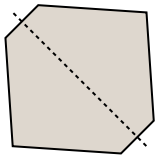

4)

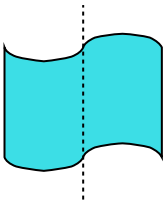

5)



6)

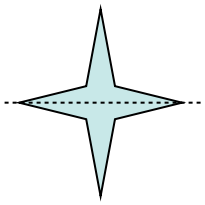

7)

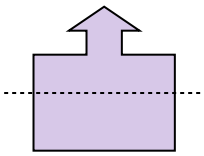

8)

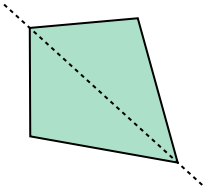

9)

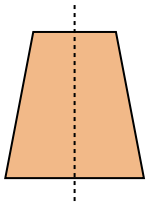

10)

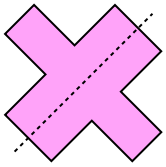

11)

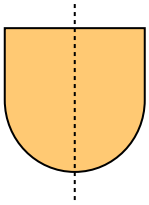

Answers

Ex. no

1. _____

2. _____

3. _____

4. _____

5. _____

6. _____

7. _____

8. _____

9. _____

10. _____

11. _____

1-10	91	82	73	64	55	45	36	27	18	9
11	0									

Determining Symmetry

Name: **Answer Key**

Determine if the line through the figure is a line of symmetry.

Ex)

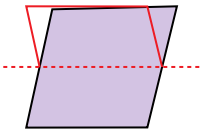

1)

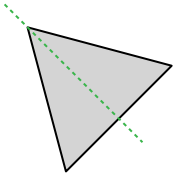

2)

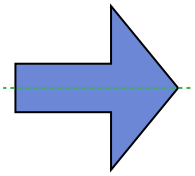

3)

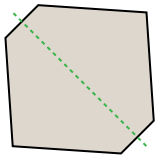

4)

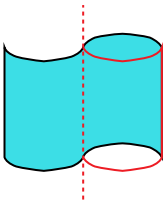

5)

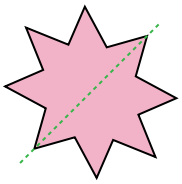

6)

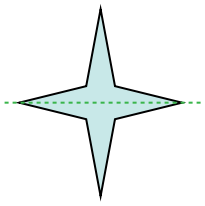

7)

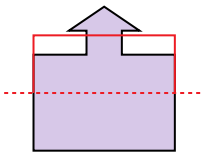

8)

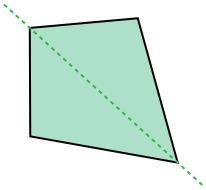

9)

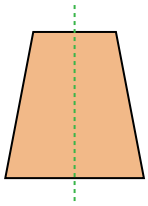

10)

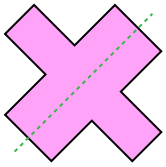

11)

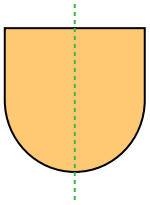

Answers

Ex.	no
1.	yes
2.	yes
3.	yes
4.	no
5.	yes
6.	yes
7.	no
8.	yes
9.	yes
10.	yes
11.	yes

1-10	91	82	73	64	55	45	36	27	18	9
11	0									