Rewriting Multiplication Problems (visual)

Name:

Write each array as a multiplication problem and solve.

Ex)

1)



2)

3)

4)

5)



6)

7)

8)

9)



10)

11)



Answers

Ex. **6 × 3 = 18**

1. _____
2. _____
3. _____
4. _____
5. _____
6. _____
7. _____
8. _____
9. _____
10. _____
11. _____

1-10	91	82	73	64	55	45	36	27	18	9
11	0									

Rewriting Multiplication Problems (visual) Name: **Answer Key**

Write each array as a multiplication problem and solve.

Ex)

1) 

2)

3)

4)

5) 

6)

7)

8)

9) 

10)

11) 

Answers

Ex. 6 × 3 = 18

1. 10 × 9 = 90
2. 9 × 5 = 45
3. 5 × 2 = 10
4. 8 × 4 = 32
5. 9 × 10 = 90
6. 3 × 2 = 6
7. 4 × 9 = 36
8. 10 × 3 = 30
9. 10 × 7 = 70
10. 2 × 8 = 16
11. 3 × 4 = 12

1-10	91	82	73	64	55	45	36	27	18	9
11	0									