Finding Distance on a Grid

Name:

Find the distance between points.

Ex)

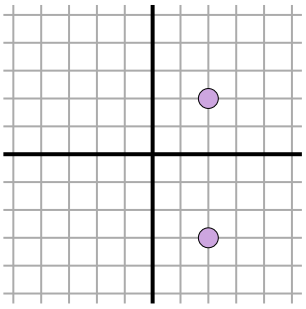

1)

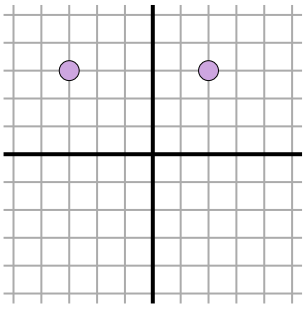

2)

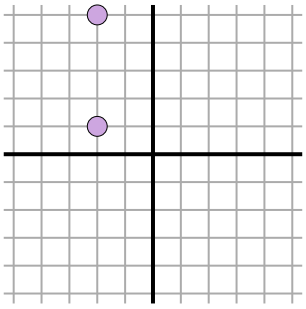

3)

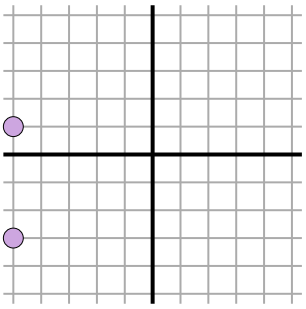

4)

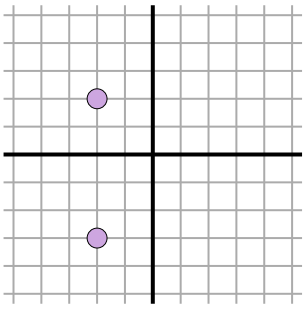

5)

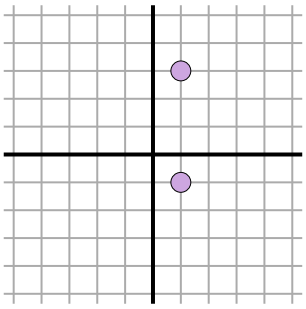

6)

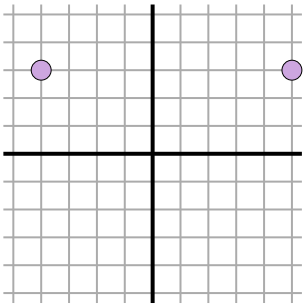

7)

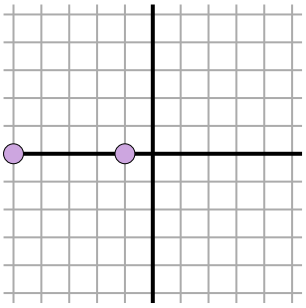

8)

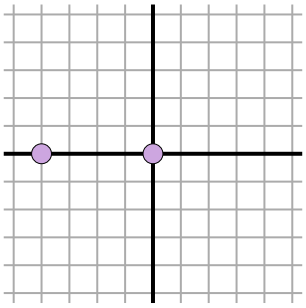

9)

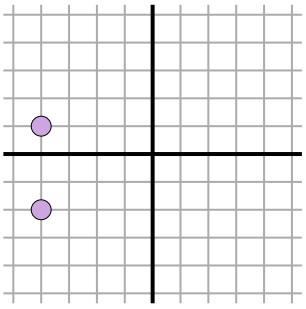

10)

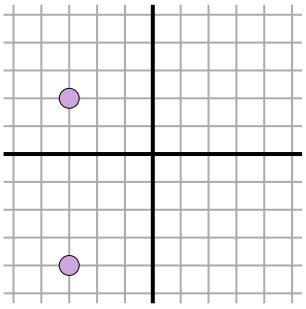

11)

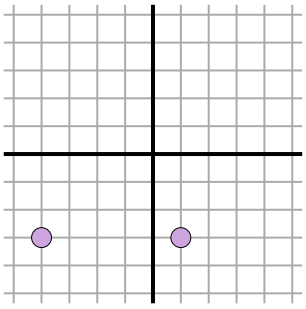

Answers

Ex. 5

1. _____

2. _____

3. _____

4. _____

5. _____

6. _____

7. _____

8. _____

9. _____

10. _____

11. _____

1-10	91	82	73	64	55	45	36	27	18	9
11	0									

Finding Distance on a Grid

Name: **Answer Key**

Find the distance between points.

Ex)

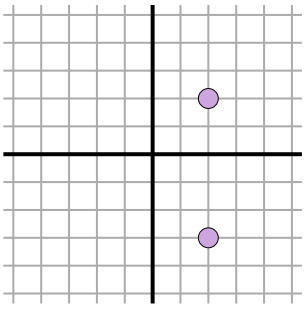

$\sqrt{(2-2)^2 + (2--3)^2}$

$\sqrt{(0) + (25)}$

1)

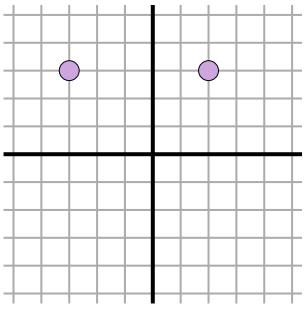

$\sqrt{(2--3)^2 + (3-3)^2}$

$\sqrt{(25) + (0)}$

2)

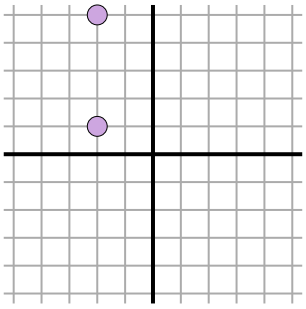

$\sqrt{(-2--2)^2 + (1-5)^2}$

$\sqrt{(0) + (16)}$

3)

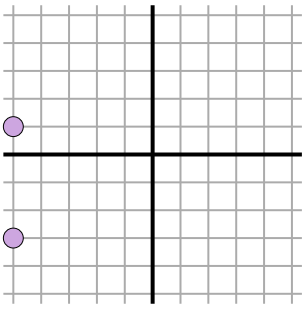

$\sqrt{(-5--5)^2 + (1--3)^2}$

$\sqrt{(0) + (16)}$

4)

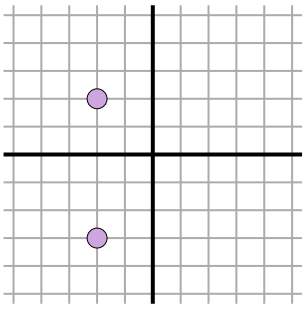

$\sqrt{(-2--2)^2 + (-3-2)^2}$

$\sqrt{(0) + (25)}$

5)

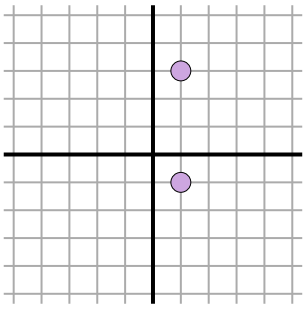

$\sqrt{(1-1)^2 + (-1-3)^2}$

$\sqrt{(0) + (16)}$

6)

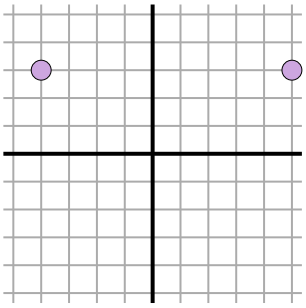

$\sqrt{(-4-5)^2 + (3-3)^2}$

$\sqrt{(81) + (0)}$

7)

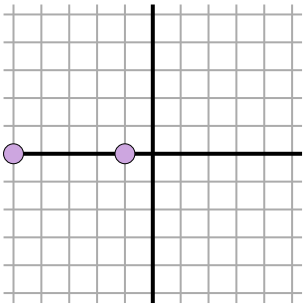

$\sqrt{(-5--1)^2 + (0-0)^2}$

$\sqrt{(16) + (0)}$

8)

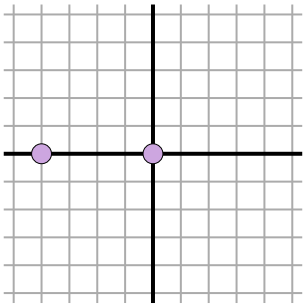

$\sqrt{(0--4)^2 + (0-0)^2}$

$\sqrt{(16) + (0)}$

9)

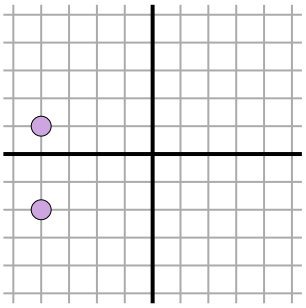

$\sqrt{(-4--4)^2 + (-2-1)^2}$

$\sqrt{(0) + (9)}$

10)

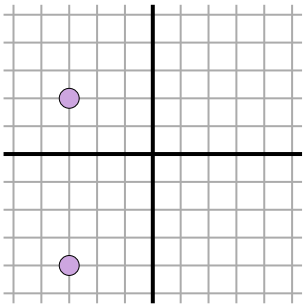

$\sqrt{(-3--3)^2 + (-4-2)^2}$

$\sqrt{(0) + (36)}$

11)

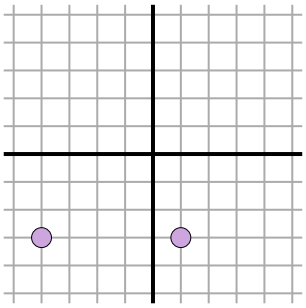

$\sqrt{(-4-1)^2 + (-3--3)^2}$

$\sqrt{(25) + (0)}$

Answers

Ex.	5
1.	5
2.	4
3.	4
4.	5
5.	4
6.	9
7.	4
8.	4
9.	3
10.	6
11.	5

1-10	91	82	73	64	55	45	36	27	18	9
11	0									