Creating Rectangles with a Coordinate Grid Name:

Find the coordinates of point D to make a rectangle.

Ex)

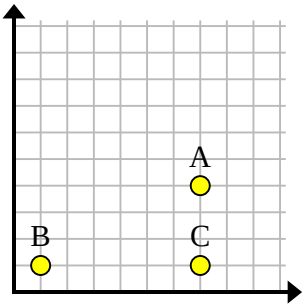

1)

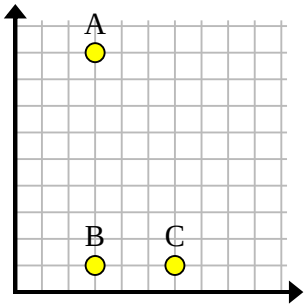

2)

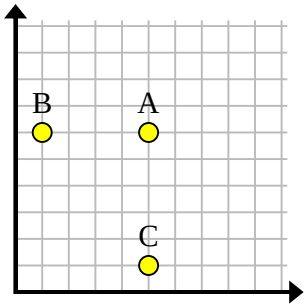

3)

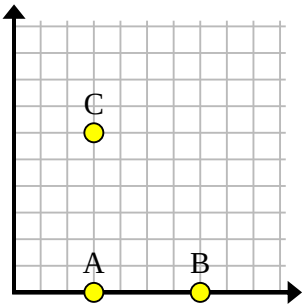

4)

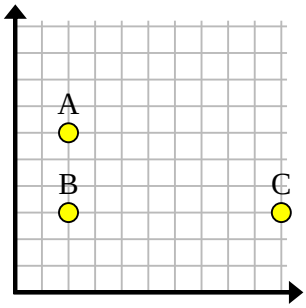

5)

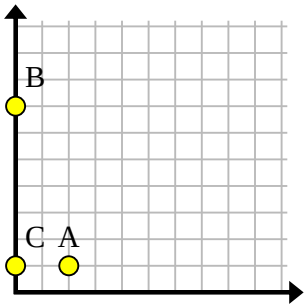

6)

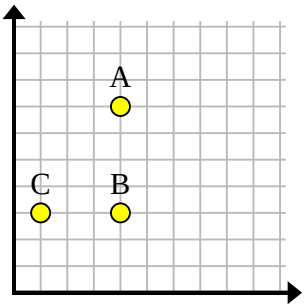

7)

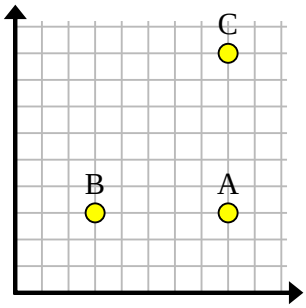

8)

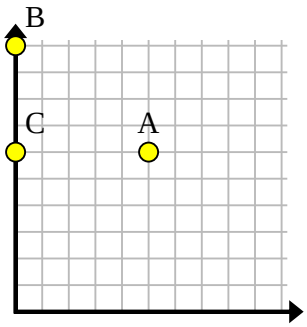

9)

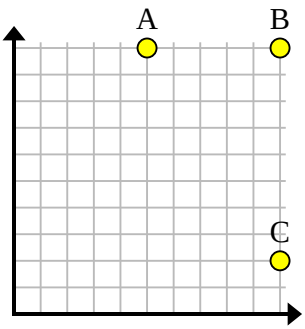

10)

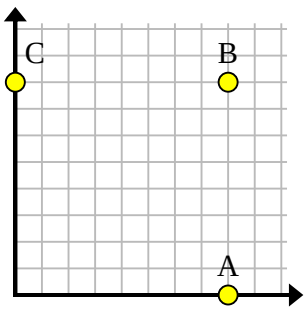

11)

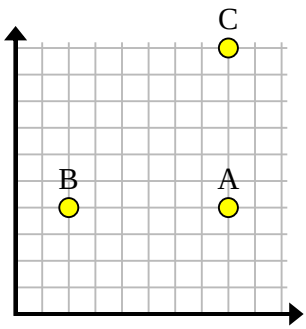

Answers

Ex. (1 , 4)

1. _____
2. _____
3. _____
4. _____
5. _____
6. _____
7. _____
8. _____
9. _____
10. _____
11. _____

1-10	91	82	73	64	55	45	36	27	18	9
11	0									

Creating Rectangles with a Coordinate Grid Name: **Answer Key**

Find the coordinates of point D to make a rectangle.

Ex)

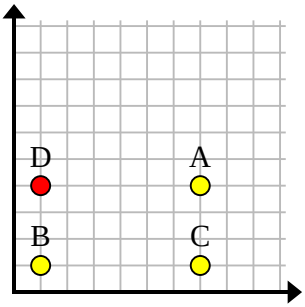

1)

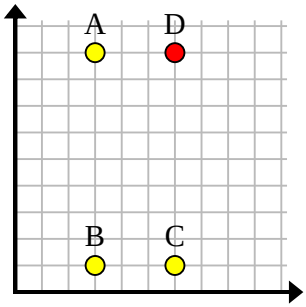

2)

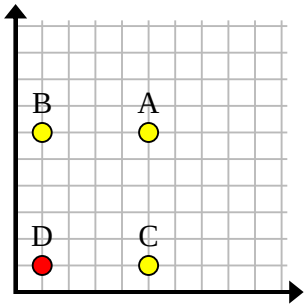

3)

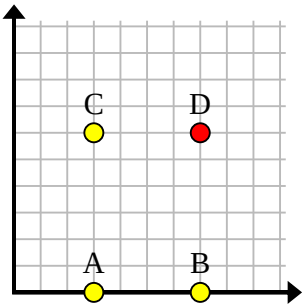

4)

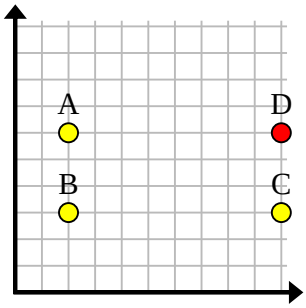

5)

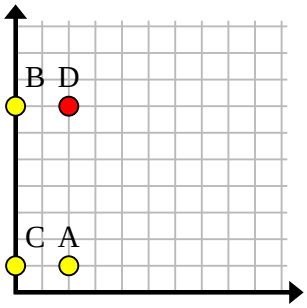

6)

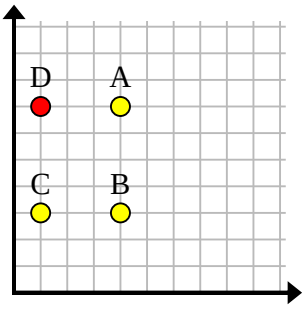

7)

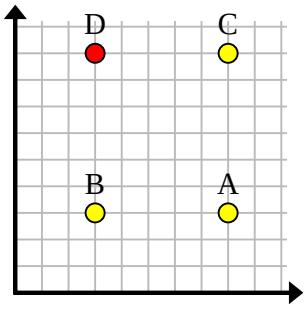

8)

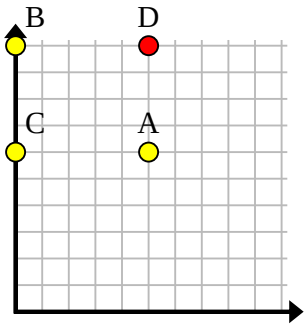

9)

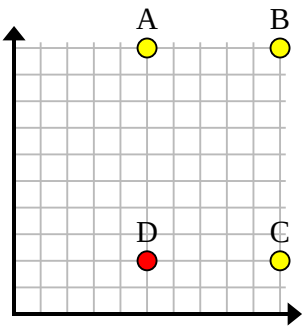

10)

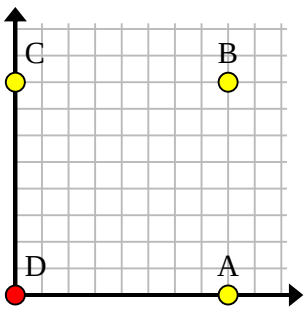

11)

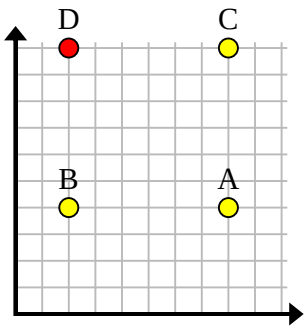

Answers

Ex.	(1 , 4)
1.	(6 , 9)
2.	(1 , 1)
3.	(7 , 6)
4.	(10 , 6)
5.	(2 , 7)
6.	(1 , 7)
7.	(3 , 9)
8.	(5 , 10)
9.	(5 , 2)
10.	(0 , 0)
11.	(2 , 10)

1-10	91	82	73	64	55	45	36	27	18	9
11	0									