Creating Rectangles with a Coordinate Grid Name:

Find the coordinates of point D to make a rectangle.

Ex)

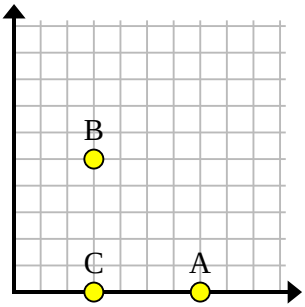

1)

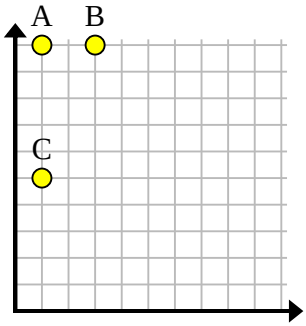

2)

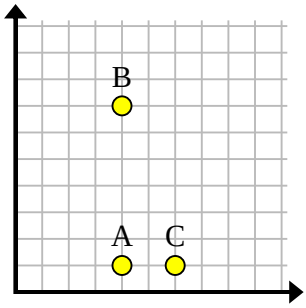

3)

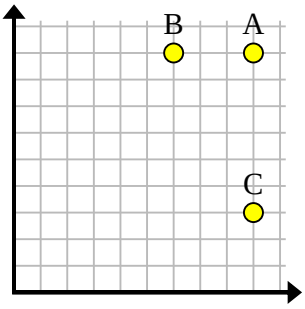

4)

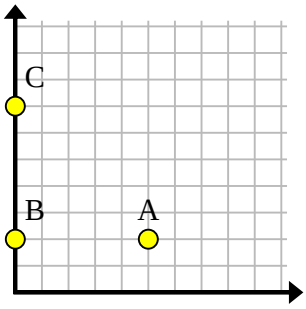

5)

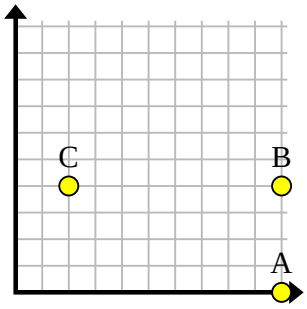

6)

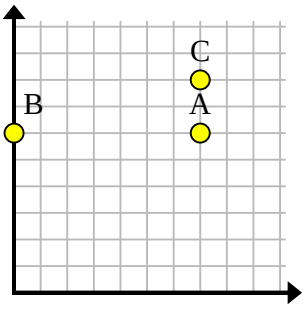

7)

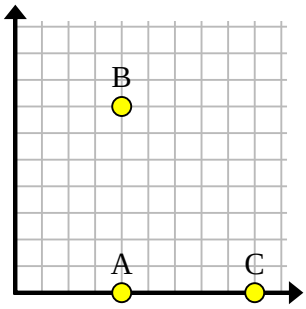

8)

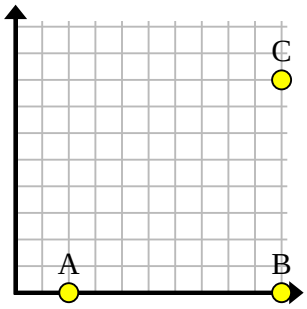

9)

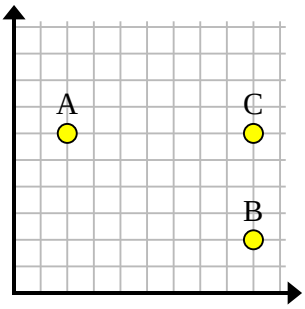

10)

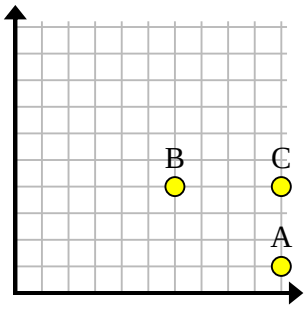

11)

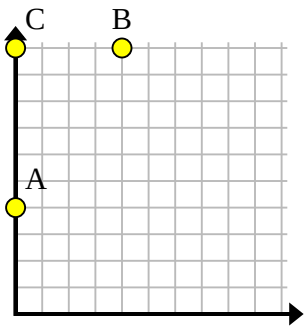

Answers

Ex. (7,5)

1. _____
2. _____
3. _____
4. _____
5. _____
6. _____
7. _____
8. _____
9. _____
10. _____
11. _____

1-10	91	82	73	64	55	45	36	27	18	9
11	0									

Creating Rectangles with a Coordinate Grid Name: **Answer Key**

Find the coordinates of point D to make a rectangle.

Ex)

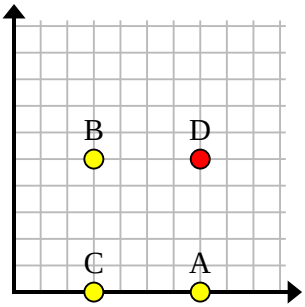

1)

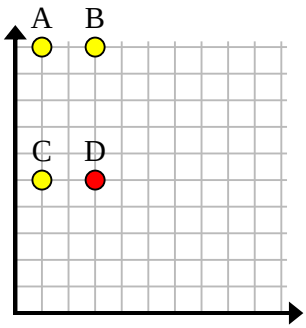

2)

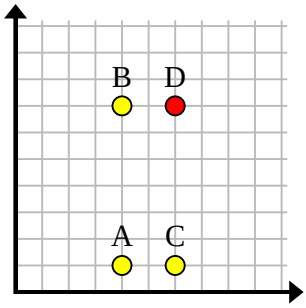

3)

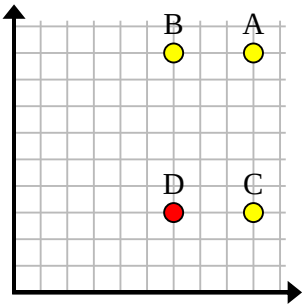

4)

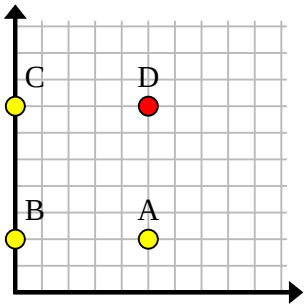

5)

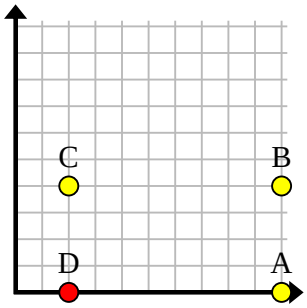

6)

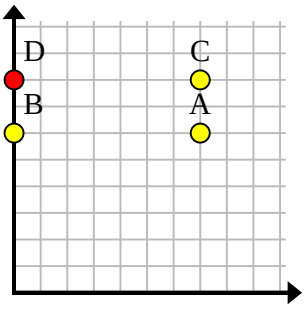

7)

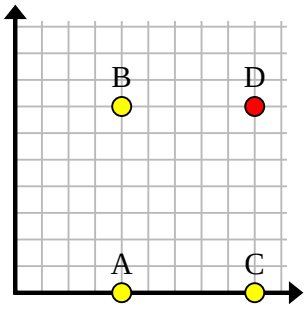

8)

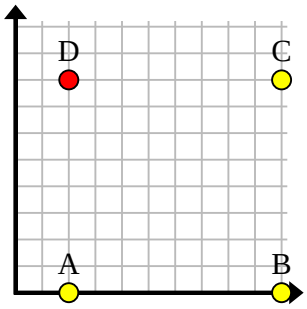

9)

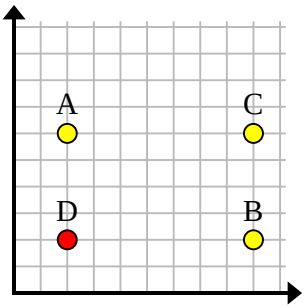

10)

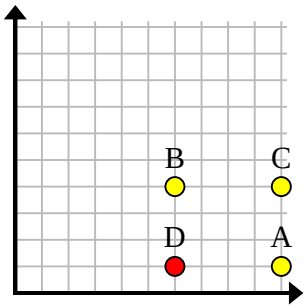

11)

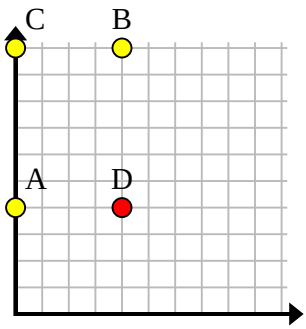

Answers

Ex.	(7,5)
1.	(3,5)
2.	(6,7)
3.	(6,3)
4.	(5,7)
5.	(2,0)
6.	(0,8)
7.	(9,7)
8.	(2,8)
9.	(2,2)
10.	(6,1)
11.	(4,4)

1-10	91	82	73	64	55	45	36	27	18	9
11	0									