Fraction Quantity Relative to Whole

Name:

Solve each problem.

Ex) Express the pentagons as a fraction of the entire set.

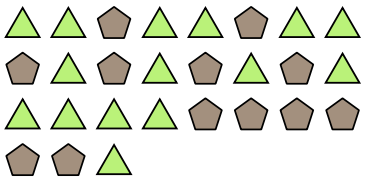

1) Express the circles as a fraction of the entire set.



2) Express the stars as a fraction of the entire set.

3) Express the moons as a fraction of the entire set.

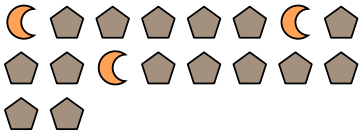

4) Express the hearts as a fraction of the entire set.

5) Express the stars as a fraction of the entire set.

6) Express the moons as a fraction of the entire set.

7) Express the pentagons as a fraction of the entire set.



8) Express the pentagons as a fraction of the entire set.

9) Express the circles as a fraction of the entire set.



10) Express the stars as a fraction of the entire set.

11) Express the triangles as a fraction of the entire set.

Answers

Ex. 12/27

1. _____
2. _____
3. _____
4. _____
5. _____
6. _____
7. _____
8. _____
9. _____
10. _____
11. _____

1-10	91	82	73	64	55	45	36	27	18	9
11	0									

Fraction Quantity Relative to Whole

Name: **Answer Key**

Solve each problem.

Ex) Express the pentagons as a fraction of the entire set.

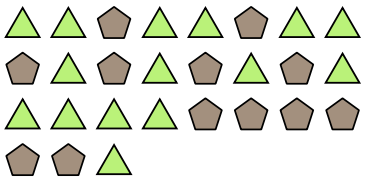

1) Express the circles as a fraction of the entire set.



2) Express the stars as a fraction of the entire set.

3) Express the moons as a fraction of the entire set.

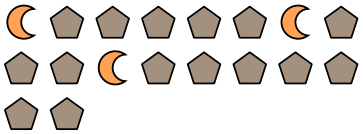

4) Express the hearts as a fraction of the entire set.

5) Express the stars as a fraction of the entire set.

6) Express the moons as a fraction of the entire set.

7) Express the pentagons as a fraction of the entire set.



8) Express the pentagons as a fraction of the entire set.

9) Express the circles as a fraction of the entire set.



10) Express the stars as a fraction of the entire set.

11) Express the triangles as a fraction of the entire set.

Answers

Ex.	12/27
1.	11/22
2.	7/16
3.	3/18
4.	9/11
5.	4/15
6.	12/20
7.	8/18
8.	11/13
9.	15/26
10.	4/9
11.	11/14

1-10	91	82	73	64	55	45	36	27	18	9
11	0									