Fraction, Decimal & Percent (Visual)

Name:

Determine the value written as a fraction , decimal & a percent.

Ex)

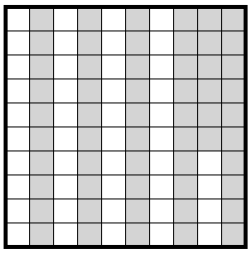

fraction $^{56}/_{100}$
decimal 0.56
percent 56

1)

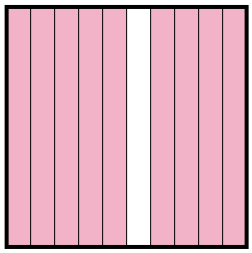

fraction _____
decimal _____
percent _____

2)

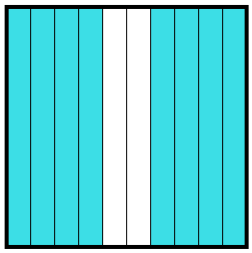

fraction _____
decimal _____
percent _____

3)

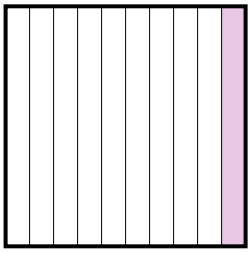

fraction _____
decimal _____
percent _____

4)

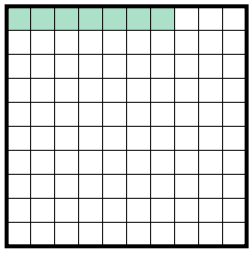

fraction _____
decimal _____
percent _____

5)

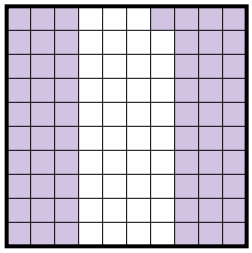

fraction _____
decimal _____
percent _____

6)



fraction _____
decimal _____
percent _____

7)

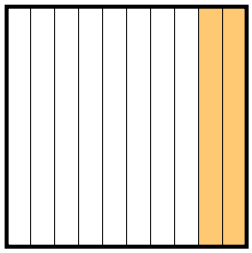

fraction _____
decimal _____
percent _____

8)



fraction _____
decimal _____
percent _____

9)

fraction _____
decimal _____
percent _____

10)

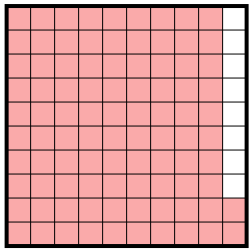

fraction _____
decimal _____
percent _____

11)

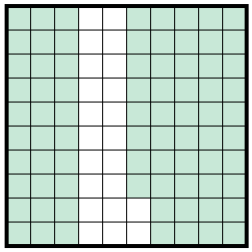

fraction _____
decimal _____
percent _____

Answers

Ex.	$^{56}/_{100}$	0.56	56%
1.			
2.			
3.			
4.			
5.			
6.			
7.			
8.			
9.			
10.			
11.			

1-10	91	82	73	64	55	45	36	27	18	9
11	0									

Fraction, Decimal & Percent (Visual)

Name: **Answer Key**

Determine the value written as a fraction , decimal & a percent.

Ex)

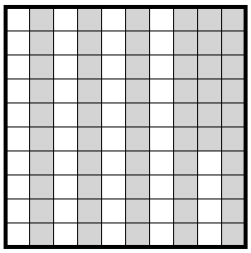

fraction $56/100$
decimal 0.56
percent 56

1)

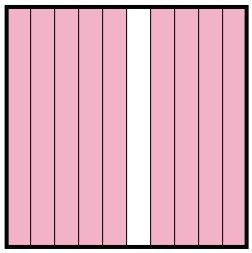

fraction $9/10$
decimal 0.9
percent 90

2)

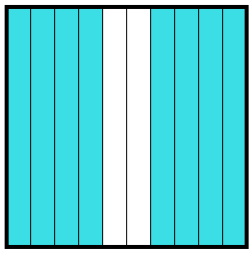

fraction $8/10$
decimal 0.8
percent 80

3)

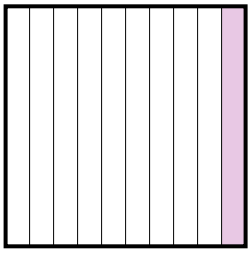

fraction $1/10$
decimal 0.1
percent 10

4)

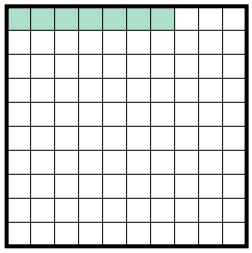

fraction $7/100$
decimal 0.07
percent 7

5)

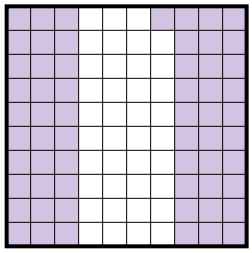

fraction $61/100$
decimal 0.61
percent 61

6)



fraction $5/10$
decimal 0.5
percent 50

7)

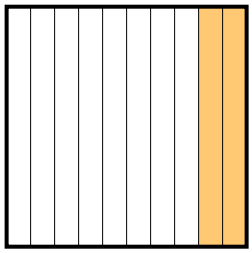

fraction $2/10$
decimal 0.2
percent 20

8)



fraction $3/10$
decimal 0.3
percent 30

9)

fraction $6/10$
decimal 0.6
percent 60

10)

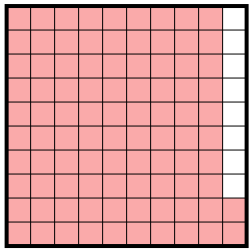

fraction $92/100$
decimal 0.92
percent 92

11)

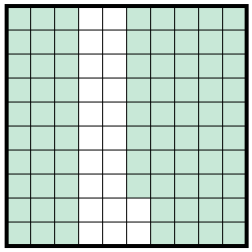

fraction $78/100$
decimal 0.78
percent 78

Answers

Ex.	$56/100$	0.56	56%
1.	$9/10$	0.9	90%
2.	$8/10$	0.8	80%
3.	$1/10$	0.1	10%
4.	$7/100$	0.07	7%
5.	$61/100$	0.61	61%
6.	$5/10$	0.5	50%
7.	$2/10$	0.2	20%
8.	$3/10$	0.3	30%
9.	$6/10$	0.6	60%
10.	$92/100$	0.92	92%
11.	$78/100$	0.78	78%

1-10	91	82	73	64	55	45	36	27	18	9
11	0									