Dividing with a Numberline

Name:

Use the numberline to solve each problem.

1) 28÷7=

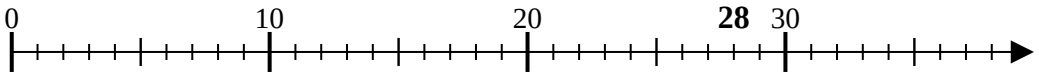

2) 12÷3=

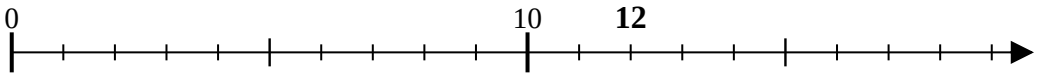

3) 10÷5=

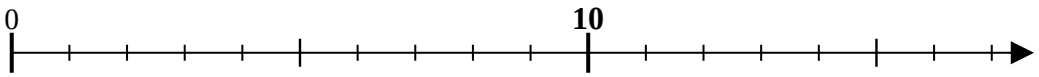

4) 4÷2=

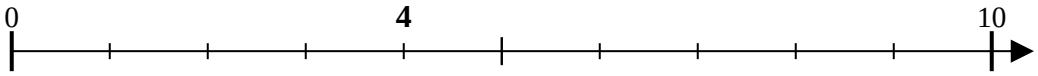

5) 15÷5=

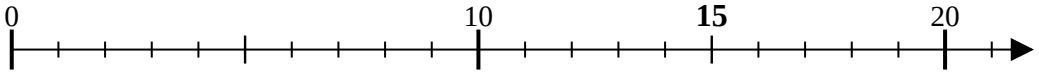

6) 8÷2=

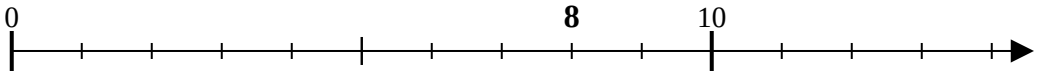

7) 12÷6=

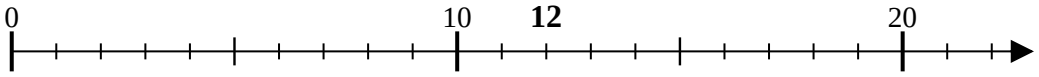

8) 36÷9=

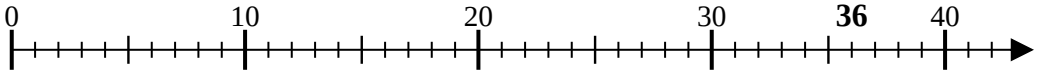

9) 20÷10=

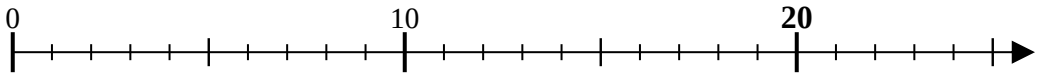

10) 30÷10=

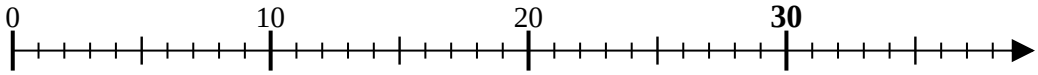

11) 15÷3=

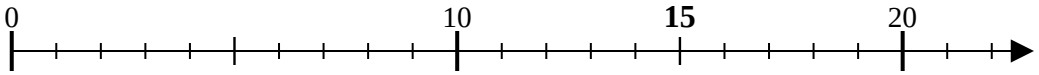

Answers

1. _____
2. _____
3. _____
4. _____
5. _____
6. _____
7. _____
8. _____
9. _____
10. _____
11. _____

1-10	91	82	73	64	55	45	36	27	18	9
11	0									

Dividing with a Numberline

Name: **Answer Key**

Use the numberline to solve each problem.

1) 28÷7=

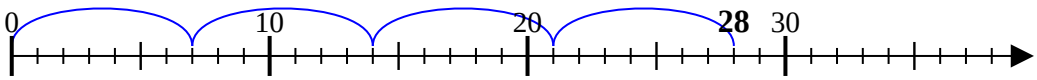

2) 12÷3=

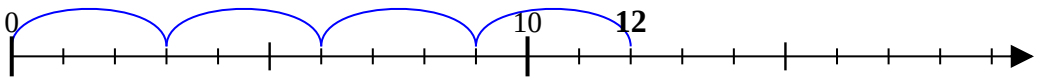

3) 10÷5=

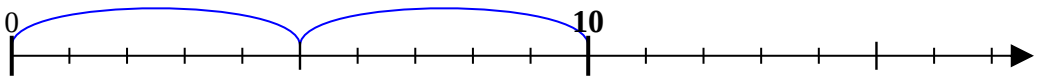

4) 4÷2=

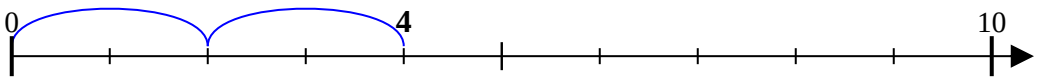

5) 15÷5=

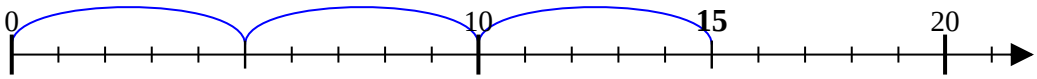

6) 8÷2=

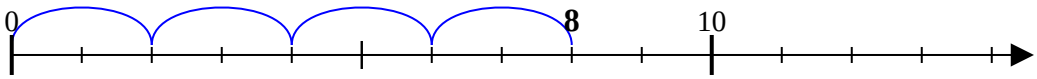

7) 12÷6=

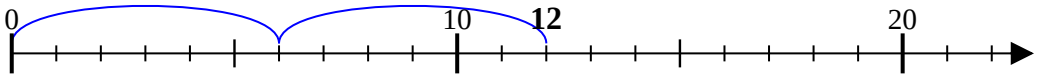

8) 36÷9=

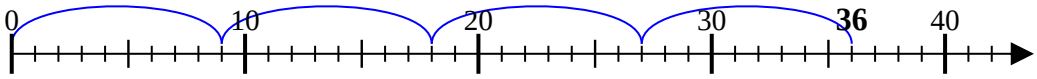

9) 20÷10=

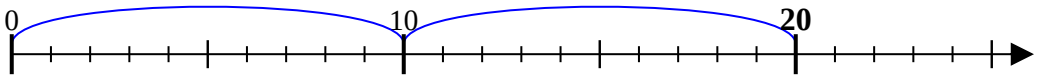

10) 30÷10=

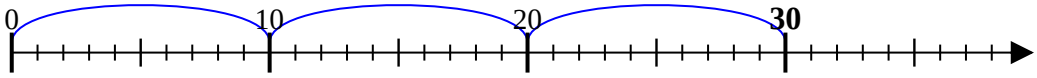

11) 15÷3=

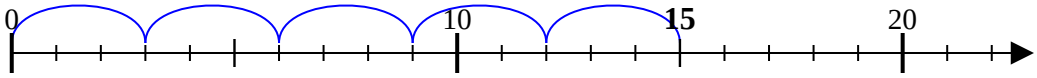

Answers

1. 4
2. 4
3. 2
4. 2
5. 3
6. 4
7. 2
8. 4
9. 2
10. 3
11. 5

1-10	91	82	73	64	55	45	36	27	18	9
11	0									