Completing and Matching Volume Equations

Name:

Match each problem with the equation that could represent it. Answer with the missing term and letter.

Ex) 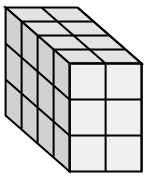

1) 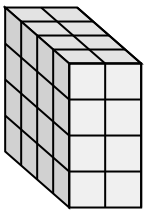

2) 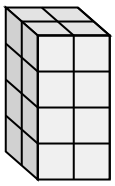

3) 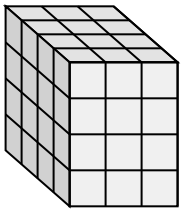

4) 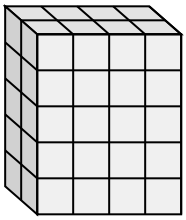

5) 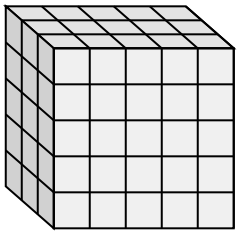

6) 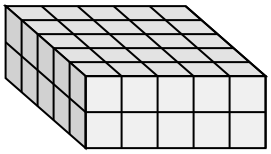

7) 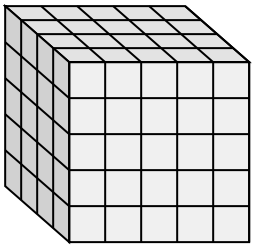

8) 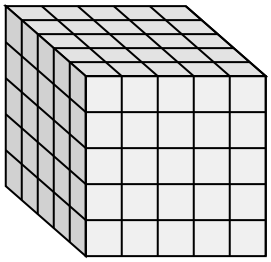

9) 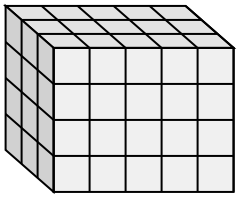

10) 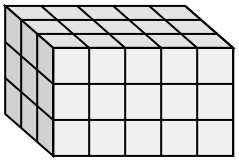

11) 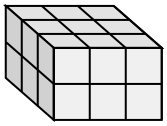

A. 3 × ___ × 4 = 60

B. ___ × 4 × 5 = 40

C. 3 × ___ × 2 = 18

D. ___ × 2 × 3 = 24

E. ___ × 2 × 4 = 16

F. 3 × ___ × 3 = 45

G. 4 × ___ × 5 = 100

H. 5 × 5 × 2 = ___

I. 4 × 2 × ___ = 32

J. ___ × 5 × 5 = 75

K. 4 × 3 × ___ = 48

L. 5 × 5 × ___ = 125

Answers

Ex. D , 4

1. _____
2. _____
3. _____
4. _____
5. _____
6. _____
7. _____
8. _____
9. _____
10. _____
11. _____

1-10	91	82	73	64	55	45	36	27	18	9
11	0									

Completing and Matching Volume Equations Name: **Answer Key**

Match each problem with the equation that could represent it. Answer with the missing term and letter.

Ex) 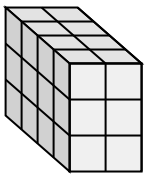

1) 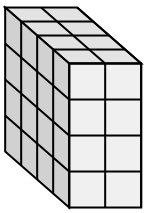

2) 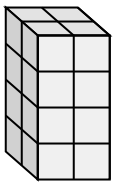

3) 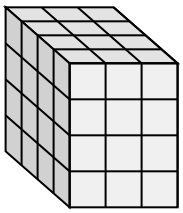

4) 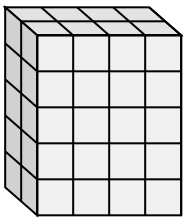

5) 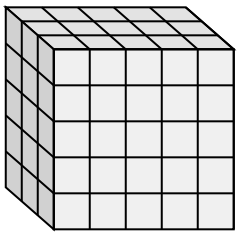

6) 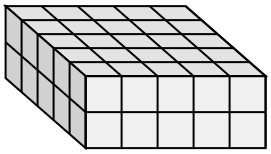

7) 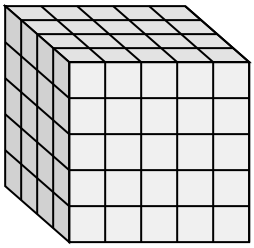

8) 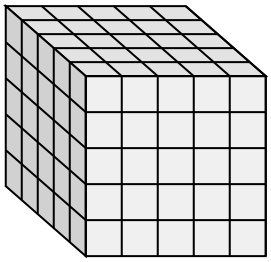

9) 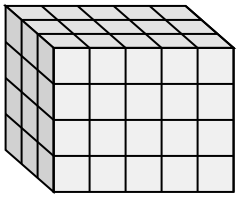

10) 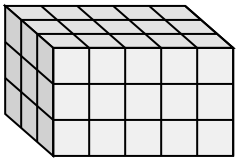

11) 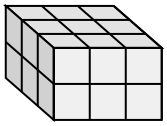

A. 3 × ___ × 4 = 60

B. ___ × 4 × 5 = 40

C. 3 × ___ × 2 = 18

D. ___ × 2 × 3 = 24

E. ___ × 2 × 4 = 16

F. 3 × ___ × 3 = 45

G. 4 × ___ × 5 = 100

H. 5 × 5 × 2 = ___

I. 4 × 2 × ___ = 32

J. ___ × 5 × 5 = 75

K. 4 × 3 × ___ = 48

L. 5 × 5 × ___ = 125

Answers

Ex. D , 4

1. I , 4

2. E , 2

3. K , 4

4. B , 2

5. J , 3

6. H , 50

7. G , 5

8. L , 5

9. A , 5

10. F , 5

11. C , 3

1-10	91	82	73	64	55	45	36	27	18	9
11	0									